HW

Name: _____ ID: A

____ 24. Determine whether the triangles are congruent.

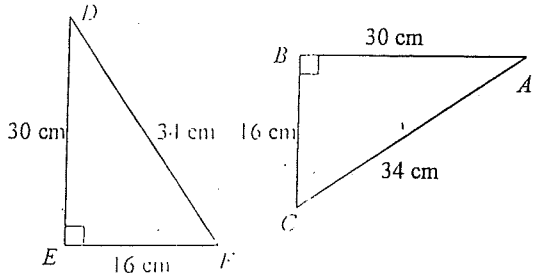

a. not congruent b. congruent

____ 25. Determine whether the triangles are congruent.

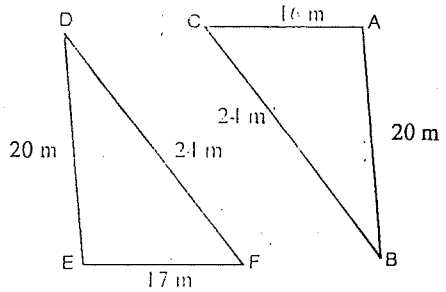

a. congruent b. not congruent

____ 26. Determine whether the triangles are congruent.

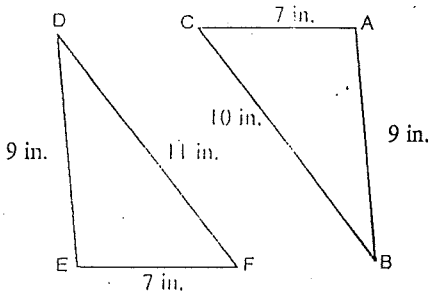

a. not congruent b. congruent

____ 27. Determine whether the triangles are congruent.

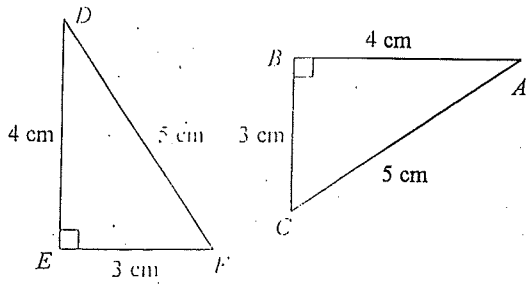

a. not congruent b. congruent